Diviser avec une Droite Numérique

Nom:

Utilisez la droite numérique pour résoudre chaque problème.

1) 35÷7=

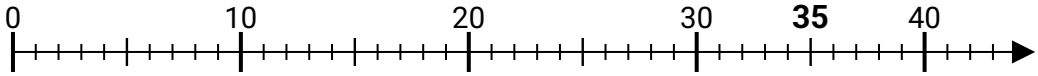

2) 18÷9=

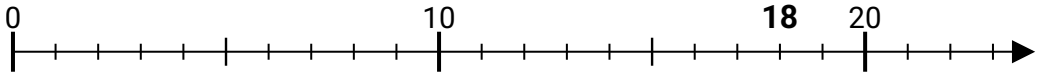

3) 20÷10=

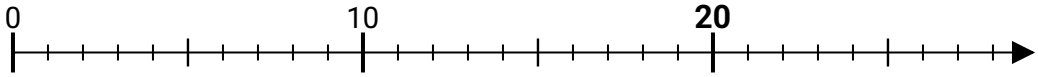

4) 24÷6=

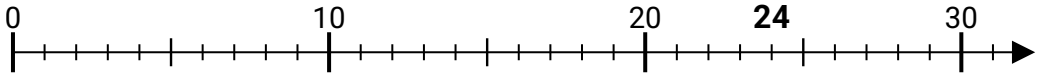

5) 24÷8=

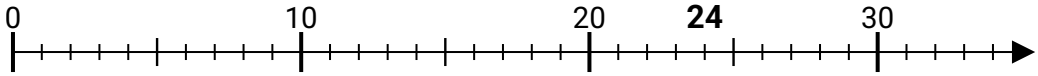

6) 36÷9=

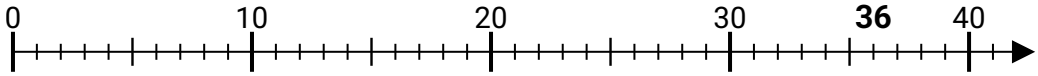

7) 21÷7=

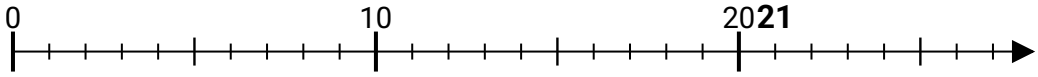

8) 4÷2=

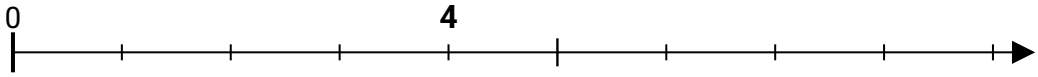

9) 40÷8=

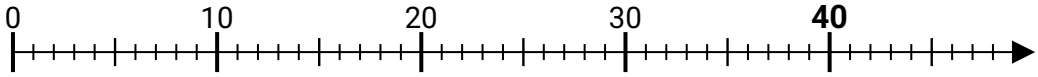

10) 28÷7=

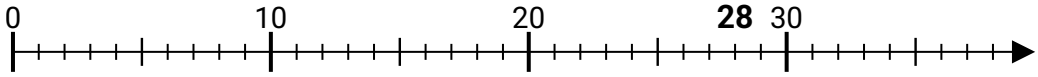

11) 20÷5=

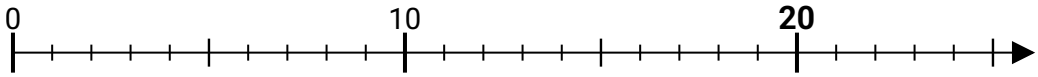

Réponses

1. _____
2. _____
3. _____
4. _____
5. _____
6. _____
7. _____
8. _____
9. _____
10. _____
11. _____

Diviser avec une Droite Numérique

Nom: **Clé**

Utilisez la droite numérique pour résoudre chaque problème.

1) 35÷7=

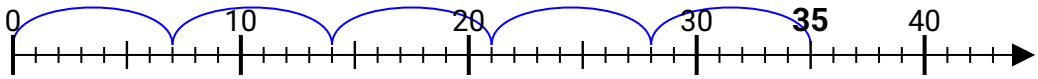

2) 18÷9=

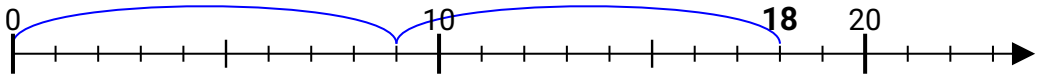

3) 20÷10=

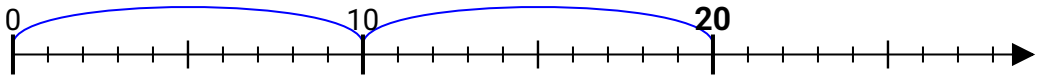

4) 24÷6=

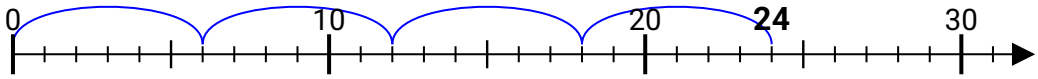

5) 24÷8=

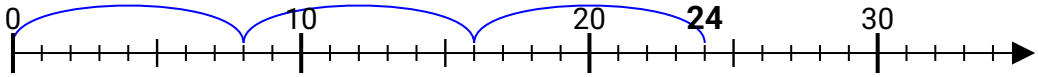

6) 36÷9=

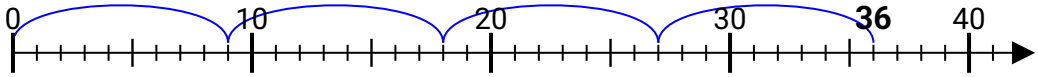

7) 21÷7=

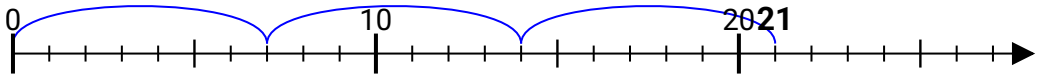

8) 4÷2=

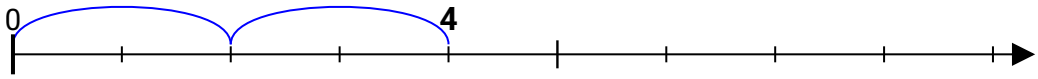

9) 40÷8=

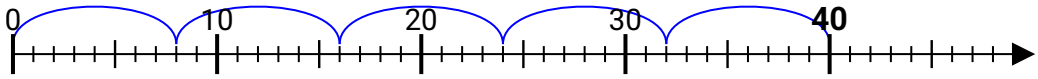

10) 28÷7=

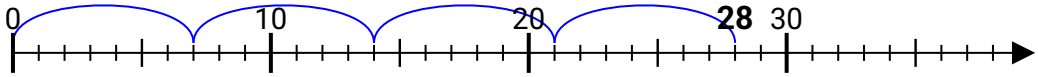

11) 20÷5=

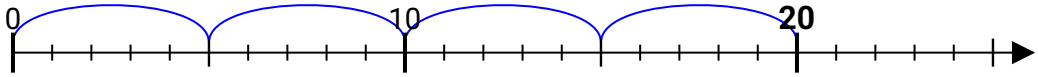

Réponses

1. 5
2. 2
3. 2
4. 4
5. 3
6. 4
7. 3
8. 2
9. 5
10. 4
11. 4