Diviser avec une Droite Numérique Nom:

Utilisez la droite numérique pour résoudre chaque problème.

1) 15÷5=

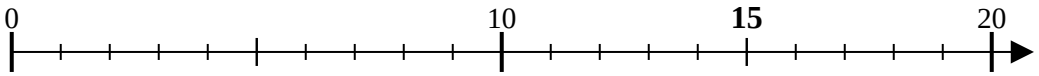

2) 16÷8=

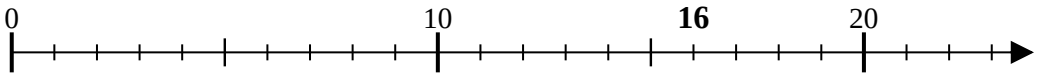

3) 8÷2=

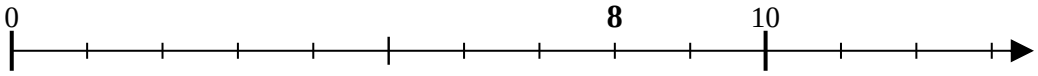

4) 36÷9=

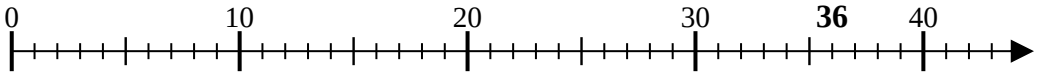

5) 10÷5=

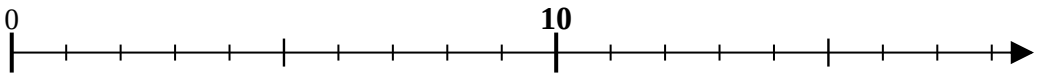

6) 16÷4=

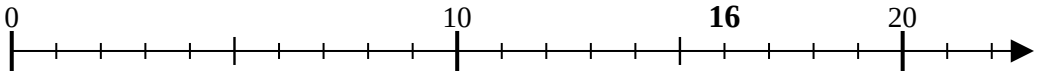

7) 6÷2=

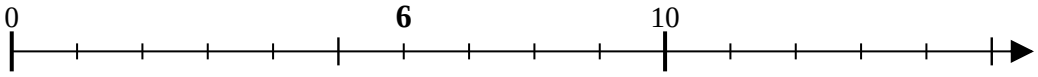

8) 12÷6=

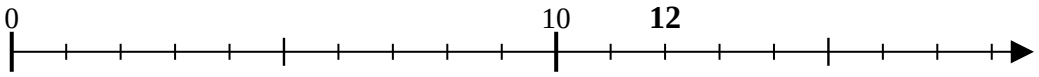

9) 6÷3=

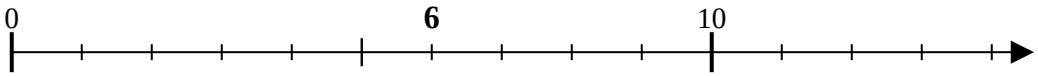

10) 18÷9=

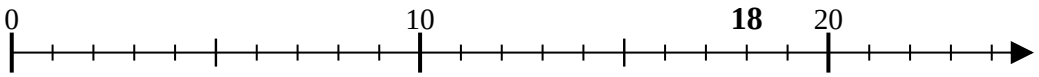

11) 45÷9=

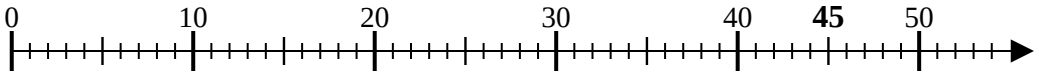

Réponses

1. _____
2. _____
3. _____
4. _____
5. _____
6. _____
7. _____
8. _____
9. _____
10. _____
11. _____

1-10	91	82	73	64	55	45	36	27	18	9
11	0									

Diviser avec une Droite Numérique Nom: **Clé**

Utilisez la droite numérique pour résoudre chaque problème.

1) 15÷5=

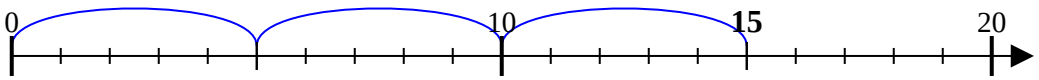

2) 16÷8=

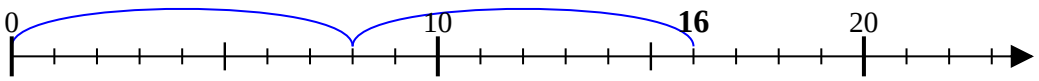

3) 8÷2=

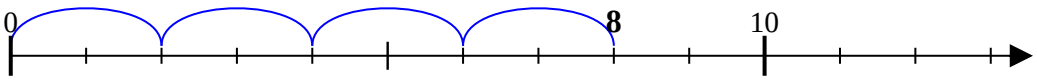

4) 36÷9=

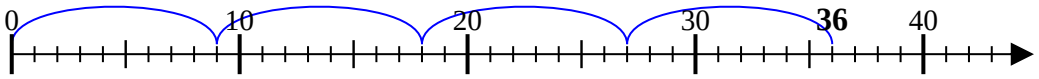

5) 10÷5=

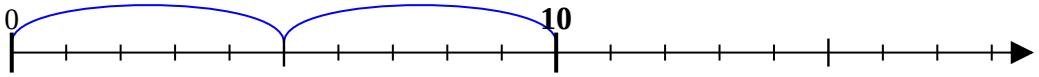

6) 16÷4=

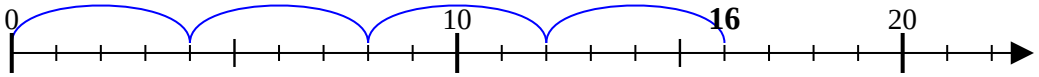

7) 6÷2=

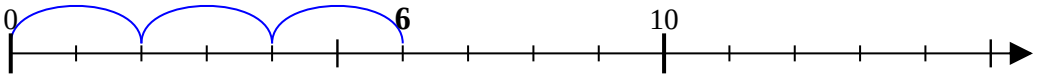

8) 12÷6=

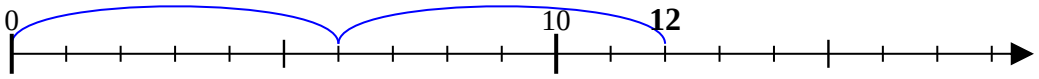

9) 6÷3=

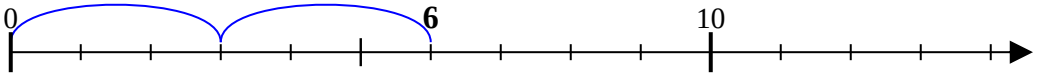

10) 18÷9=

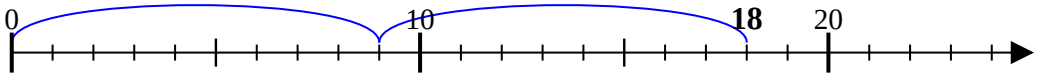

11) 45÷9=

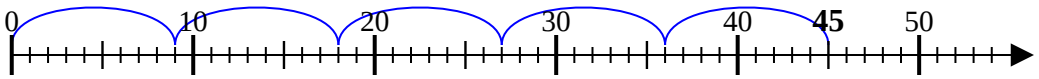

Réponses

1. 3
2. 2
3. 4
4. 4
5. 2
6. 4
7. 3
8. 2
9. 2
10. 2
11. 5

1-10	91	82	73	64	55	45	36	27	18	9
11	0									