Fractions Impropres et Nombres Mixtes (Visuel) Nom:

Exprimez chaque montant en un nombre mixte.

1) 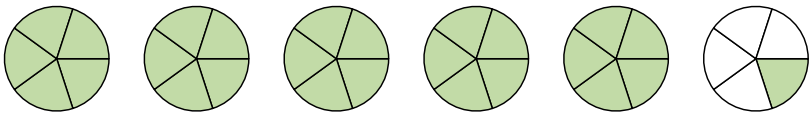

2) 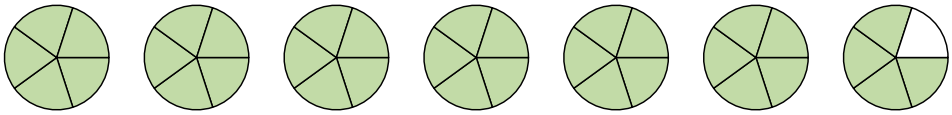

3) 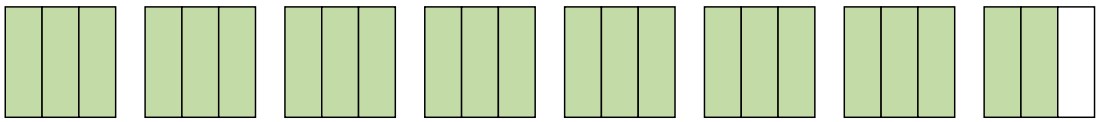

4) 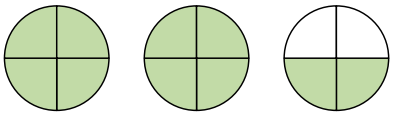

5) 

Exprimez chaque montant en une fraction impropre.

6) 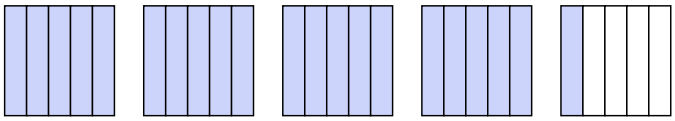

7) 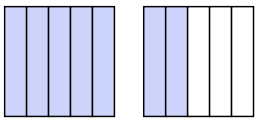

8) 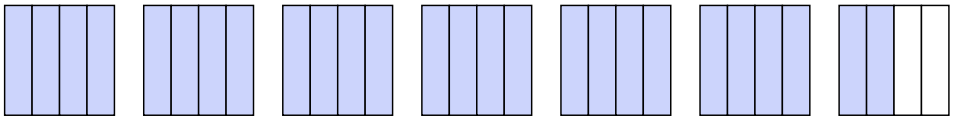

9) 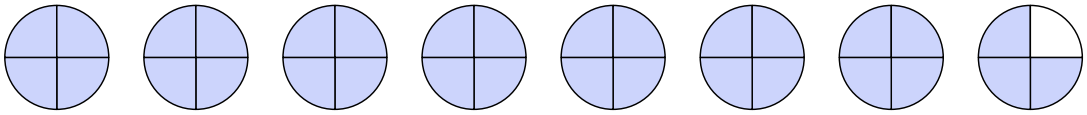

10) 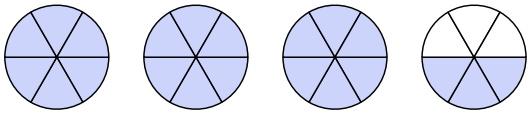

11) 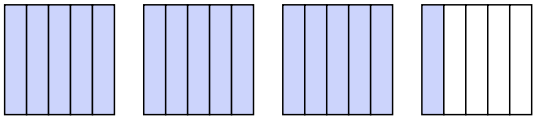

Réponses

1. _____
2. _____
3. _____
4. _____
5. _____
6. _____
7. _____
8. _____
9. _____
10. _____
11. _____

1-10	91	82	73	64	55	45	36	27	18	9
11	0									

Fractions Impropres et Nombres Mixtes (Visuel) Nom: **Clé**

Exprimez chaque montant en un nombre mixte.

1)

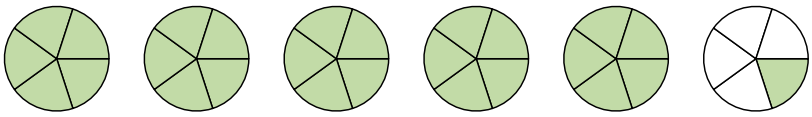

2)

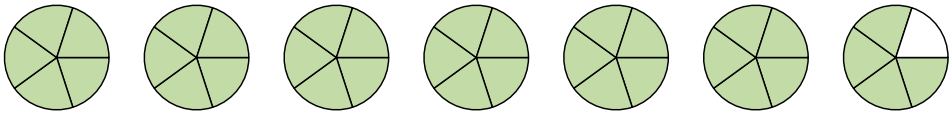

3)

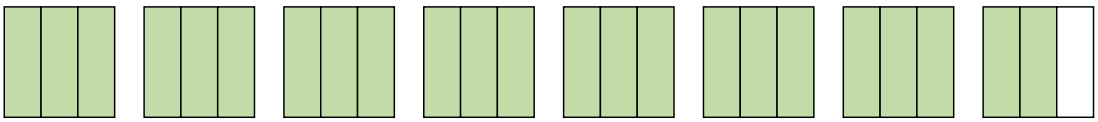

4)

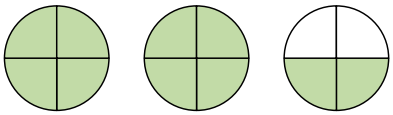

5)



Exprimez chaque montant en une fraction impropre.

6)

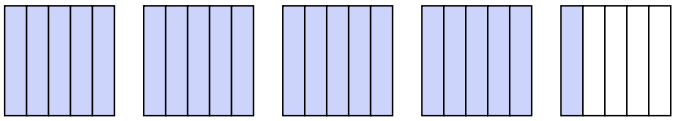

7)

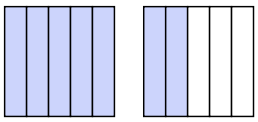

8)

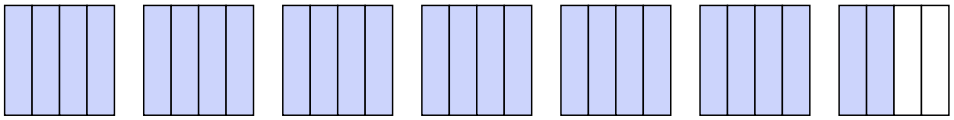

9)

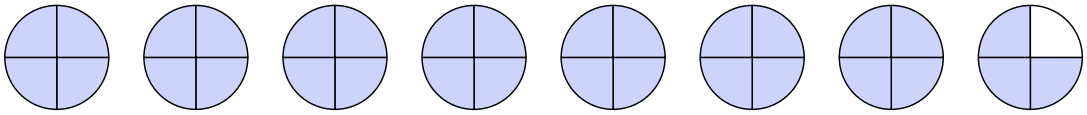

10)

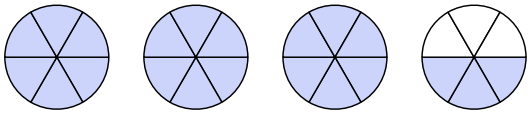

11)

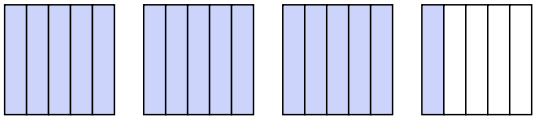

Réponses

1. $5\frac{1}{5}$
2. $6\frac{4}{5}$
3. $7\frac{2}{3}$
4. $2\frac{2}{4}$
5. $2\frac{1}{2}$
6. $\frac{21}{5}$
7. $\frac{7}{5}$
8. $\frac{26}{4}$
9. $\frac{31}{4}$
10. $\frac{21}{6}$
11. $\frac{16}{5}$

1-10	91	82	73	64	55	45	36	27	18	9
11	0									