Nommer des Fractions

Nom:

Déterminez quelle lettre représente le mieux la partie colorée de la figure.

1)

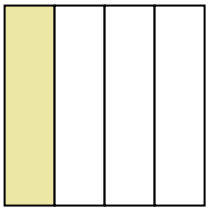

A. two-quarters
B. one-quarter
C. two-halves

2)

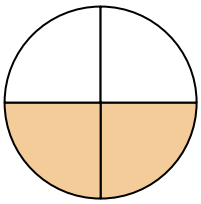

A. two-quarters
B. two-halves
C. four-quarters

3)

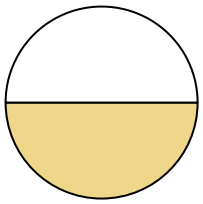

A. one-half
B. two-halves
C. one-quarter

4)



A. one-half
B. three-quarters
C. two-halves

5)

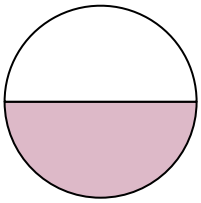

A. one-half
B. three-quarters
C. four-quarters

6)

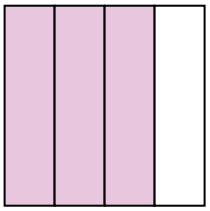

A. one-half
B. four-quarters
C. three-quarters

7)



A. one-quarter
B. two-halves
C. three-quarters

8)

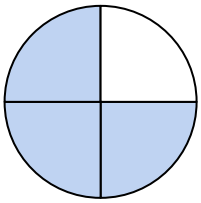

A. two-quarters
B. three-quarters
C. two-halves

9)

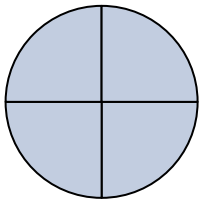

A. two-quarters
B. one-half
C. four-quarters

Réponses

1. _____
2. _____
3. _____
4. _____
5. _____
6. _____
7. _____
8. _____
9. _____

Nommer des Fractions

Nom: **Clé**

Déterminez quelle lettre représente le mieux la partie colorée de la figure.

1)

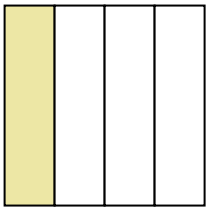

A. two-quarters
B. one-quarter
C. two-halves

2)

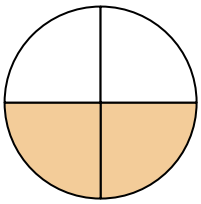

A. two-quarters
B. two-halves
C. four-quarters

3)

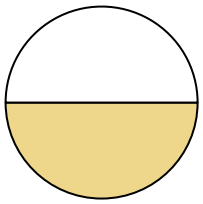

A. one-half
B. two-halves
C. one-quarter

4)



A. one-half
B. three-quarters
C. two-halves

5)

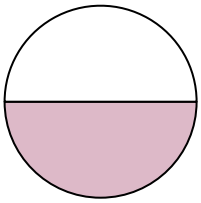

A. one-half
B. three-quarters
C. four-quarters

6)

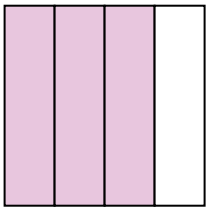

A. one-half
B. four-quarters
C. three-quarters

7)



A. one-quarter
B. two-halves
C. three-quarters

8)

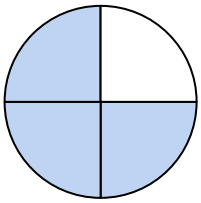

A. two-quarters
B. three-quarters
C. two-halves

9)

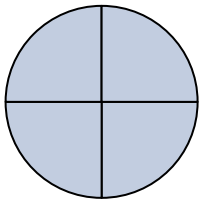

A. two-quarters
B. one-half
C. four-quarters

Réponses

1. B
2. A
3. A
4. C
5. A
6. C
7. B
8. B
9. C

1-9	89	78	67	56	44	33	22	11	0