# Exprimer des Inégalités sur une Droite Numérique

Nom:

**Utilisez la droite numérique pour exprimer l'inégalité.**

**Ex)** $X \leq 30$

**1)** $X \leq 90$

**2)** $X < -140$

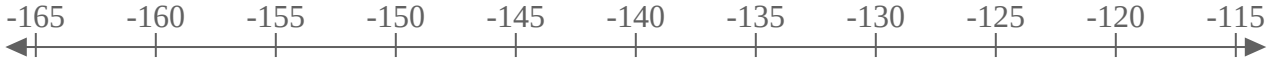


**3)** $X > -5$

**4)** $X > 30$

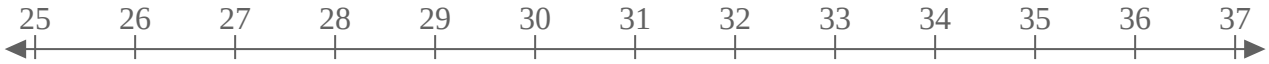


**5)** $X > 106$

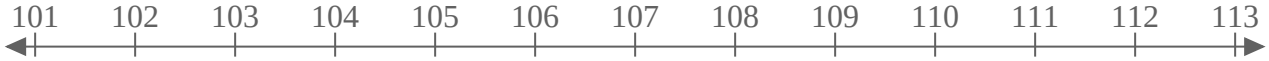


**6)** $X \leq -114$

**7)** $X > -154$

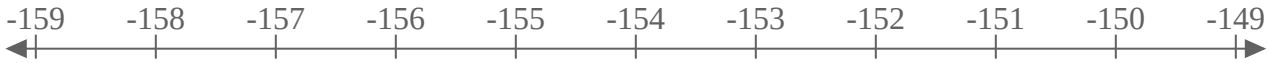


**8)** $X > 50$

**9)** $X < -116$

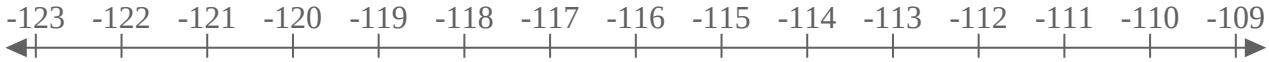


**10)** $X \geq -195$

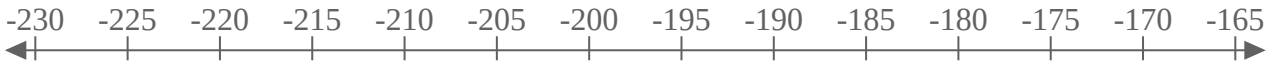


**11)** $X \geq 179$

**12)** $X \leq 149$

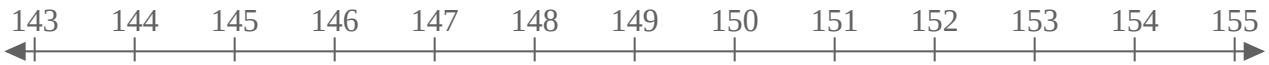


**13)** $X \geq -20$

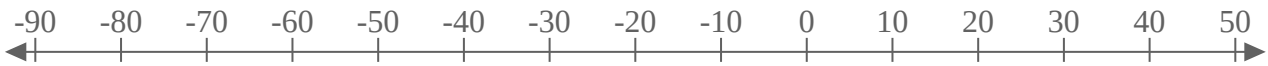




| | | | | | | | | | | |
|---|---|---|---|---|---|---|---|---|---|---|
| 1-10 | 92 | 85 | 77 | 69 | 62 | 54 | 46 | 38 | 31 | 23 |
| 11-13 | 15 | 8 | 0 | | | | | | | |

Exprimer des Inégalités sur une Droite Numérique Nom: **Clé**

**Utilisez la droite numérique pour exprimer l'inégalité.**

**Ex)** $X \leq 30$

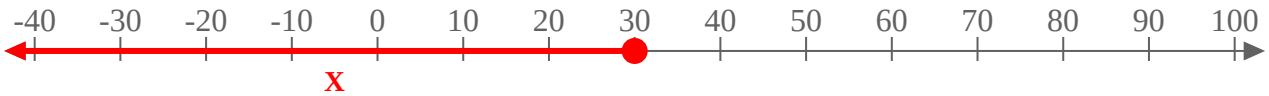


**1)** $X \leq 90$

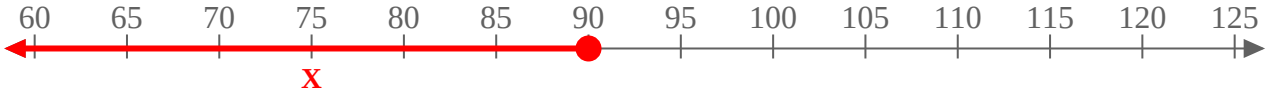


**2)** $X < -140$

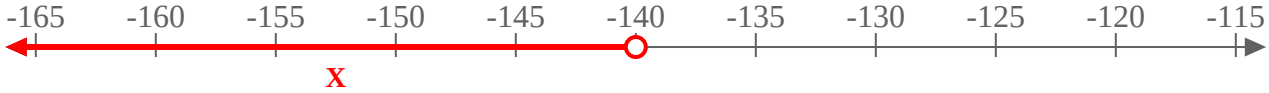


**3)** $X > -5$

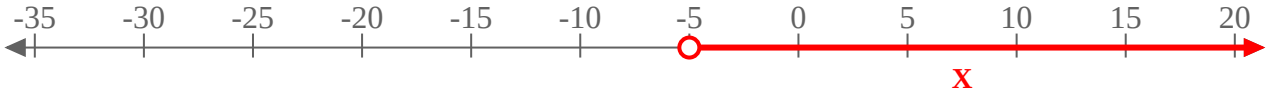


**4)** $X > 30$

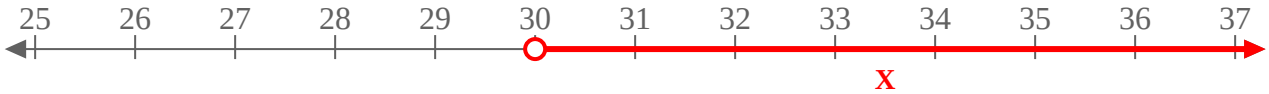


**5)** $X > 106$

**6)** $X \leq -114$

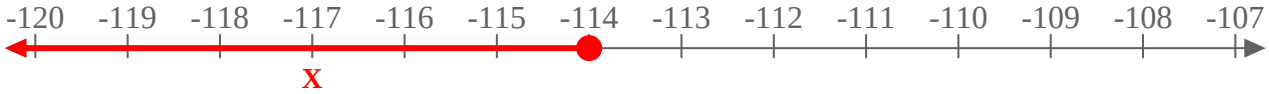


**7)** $X > -154$

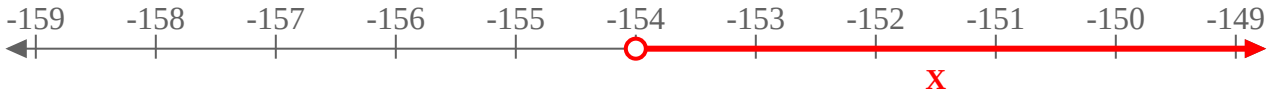


**8)** $X > 50$

**9)** $X < -116$

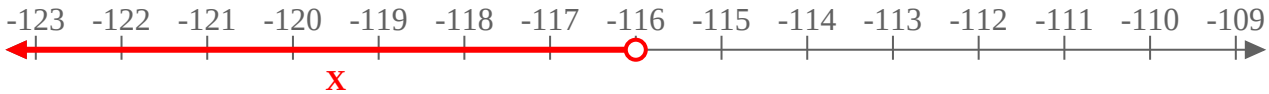


**10)** $X \geq -195$

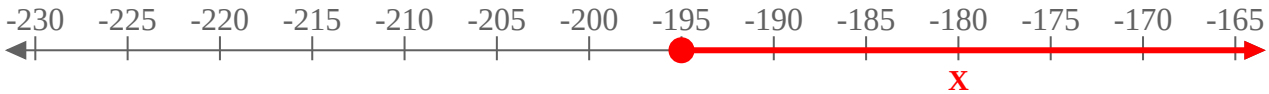


**11)** $X \geq 179$

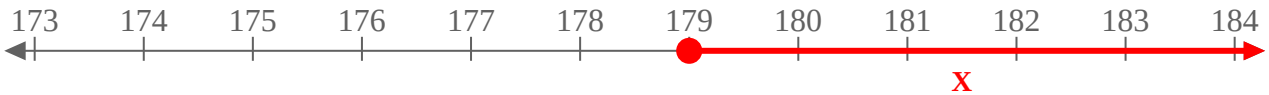


**12)** $X \leq 149$

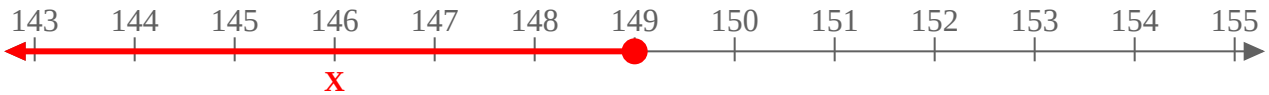


**13)** $X \geq -20$

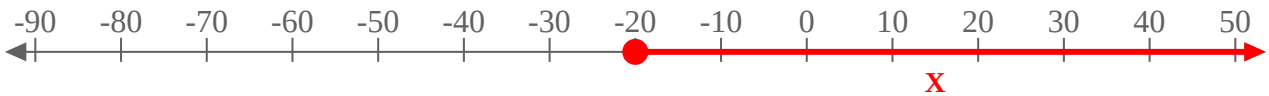




| | | | | | | | | | | |
|---|---|---|---|---|---|---|---|---|---|---|
| 1-10 | 92 | 85 | 77 | 69 | 62 | 54 | 46 | 38 | 31 | 23 |
| 11-13 | 15 | 8 | 0 | | | | | | | |