Exprimer des Inégalités sur une Droite Numérique

Nom:

Utilisez la droite numérique pour exprimer l'inégalité.

Ex) $X \leq 130$

60 70 80 90 100 110 120 130 140 150 160 170 180

1) $X > -120$

-145 -140 -135 -130 -125 -120 -115 -110 -105 -100 -95

2) $X < 87$

80 81 82 83 84 85 86 87 88 89 90 91 92 93 94

3) $X > 66$

60 61 62 63 64 65 66 67 68 69 70 71 72 73

4) $X > 43$

37 38 39 40 41 42 43 44 45 46 47 48 49

5) $X < 19$

13 14 15 16 17 18 19 20 21 22 23 24 25

6) $X < -13$

-20 -19 -18 -17 -16 -15 -14 -13 -12 -11 -10 -9 -8 -7

7) $X > 75$

70 71 72 73 74 75 76 77 78 79 80 81 82

8) $X \leq 100$

50 60 70 80 90 100 110 120 130 140 150 160

9) $X > -105$

-135 -130 -125 -120 -115 -110 -105 -100 -95 -90 -85 -80

10) $X \leq 90$

65 70 75 80 85 90 95 100 105 110 115

11) $X \geq -75$

-100 -95 -90 -85 -80 -75 -70 -65 -60 -55 -50 -45

12) $X \leq 85$

55 60 65 70 75 80 85 90 95 100 105 110 115 120

13) $X \leq 160$

100 110 120 130 140 150 160 170 180 190 200 210

1-10	92	85	77	69	62	54	46	38	31	23
11-13	15	8	0							

Exprimer des Inégalités sur une Droite Numérique Nom: **Clé**

Utilisez la droite numérique pour exprimer l'inégalité.

Ex) $X \leq 130$

1) $X > -120$

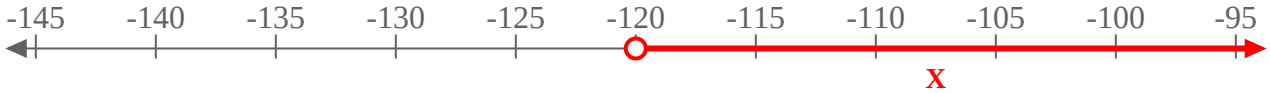

2) $X < 87$

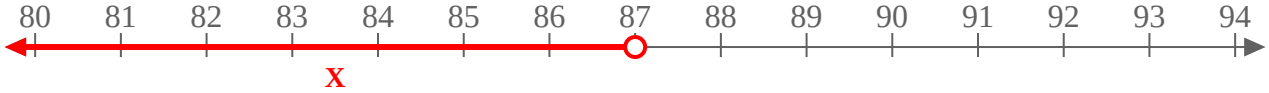

3) $X > 66$

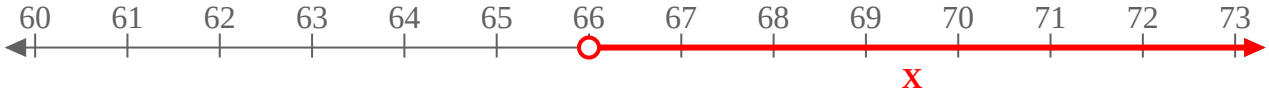

4) $X > 43$

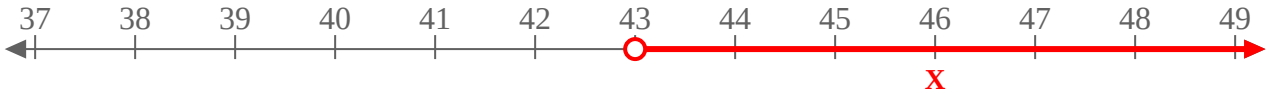

5) $X < 19$

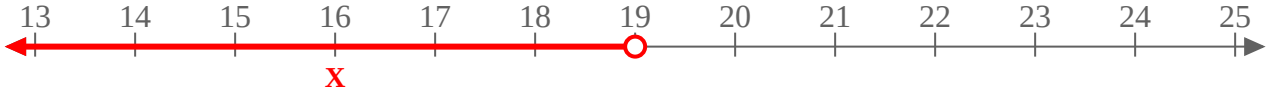

6) $X < -13$

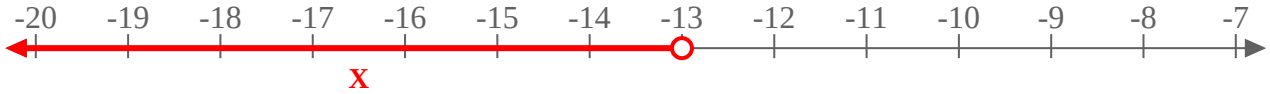

7) $X > 75$

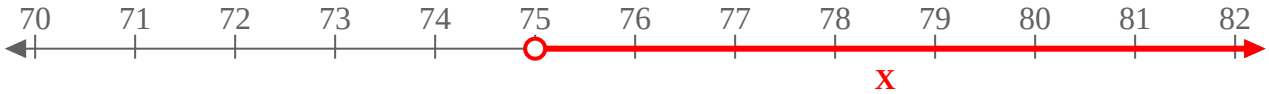

8) $X \leq 100$

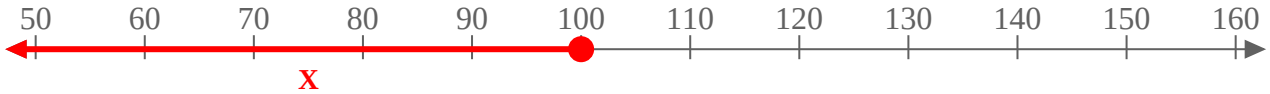

9) $X > -105$

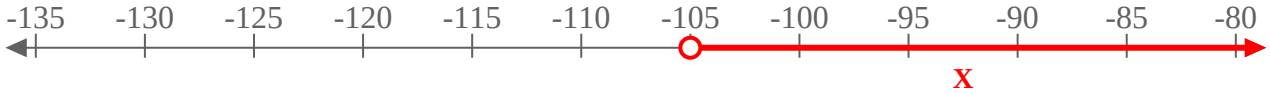

10) $X \leq 90$

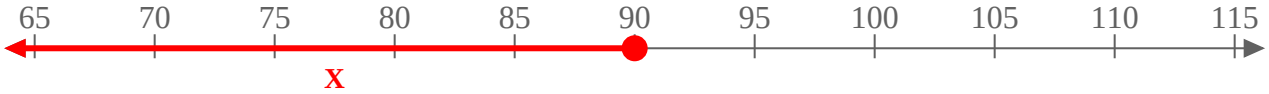

11) $X \geq -75$

12) $X \leq 85$

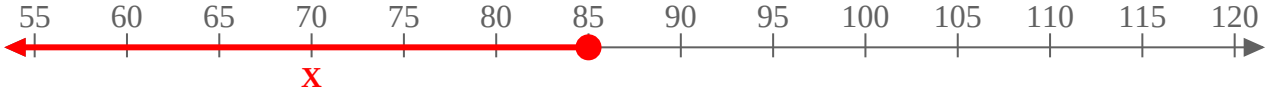

13) $X \leq 160$

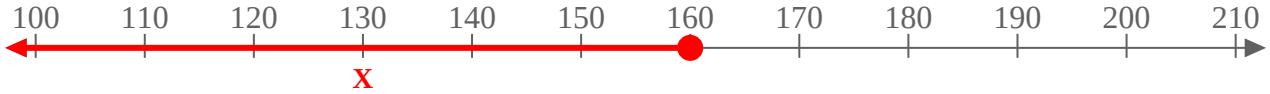

1-10	92	85	77	69	62	54	46	38	31	23
11-13	15	8	0							