Réécriture de Multiplication (Visuelle)

Nom:

Interpréter chaque figure en multiplication.

Ex)

1) 

2) 

3)

4)

5)

6)

7)

8) 

9) 

10)

11)

Réponses

Ex. **9 × 6 = 54**

1. _____
2. _____
3. _____
4. _____
5. _____
6. _____
7. _____
8. _____
9. _____
10. _____
11. _____

1-10	91	82	73	64	55	45	36	27	18	9
11	0									

Réécriture de Multiplication (Visuelle) Nom: **Clé**

Interpréter chaque figure en multiplication.

Ex)

1)



2)



3)

4)

5)

6)

7)

8)



9)



10)

11)

Réponses

Ex. **9 × 6 = 54**

1. **7 × 6 = 42**
2. **7 × 10 = 70**
3. **8 × 2 = 16**
4. **4 × 2 = 8**
5. **4 × 8 = 32**
6. **3 × 2 = 6**
7. **10 × 7 = 70**
8. **4 × 10 = 40**
9. **3 × 6 = 18**
10. **7 × 5 = 35**
11. **4 × 6 = 24**

1-10	91	82	73	64	55	45	36	27	18	9
11	0									