Machines à Fonctions (Additions & Soustractions) Nom:

Déterminez la règle appliquée à chaque machine à fonctions.

Ex)

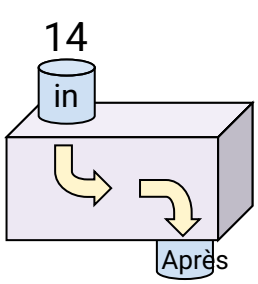

Ajouter 22

1)

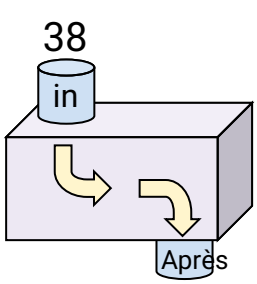

2)

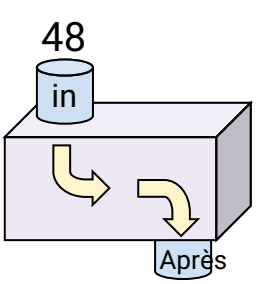

3)

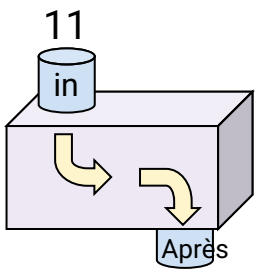

4)

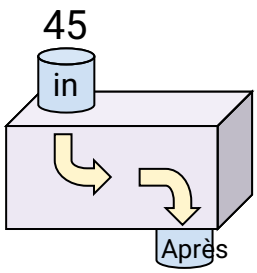

5)

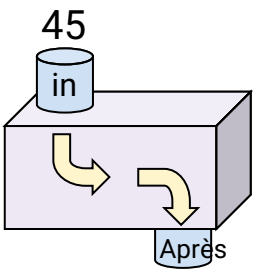

6)

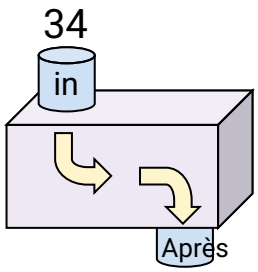

7)

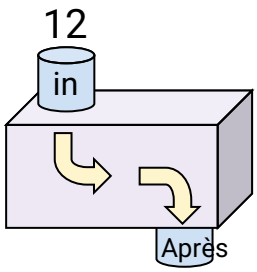

8)

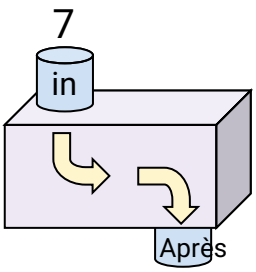

9)

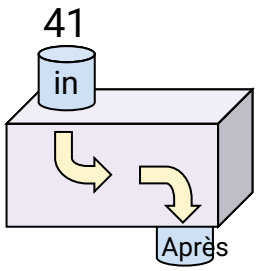

10)

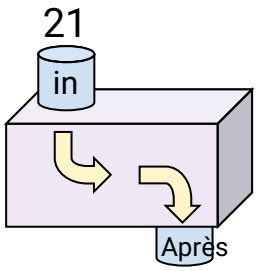

11)

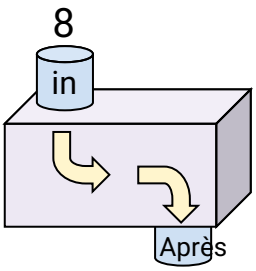

Réponses

Ex. Ajouter 22

1. _____
2. _____
3. _____
4. _____
5. _____
6. _____
7. _____
8. _____
9. _____
10. _____
11. _____

Machines à Fonctions (Additions & Soustractions) Nom: **Clé**

Déterminez la règle appliquée à chaque machine à fonctions.

Ex)

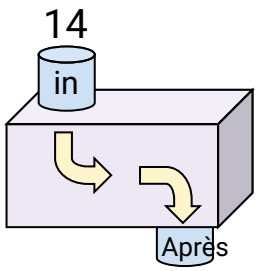

Ajouter 22

1)

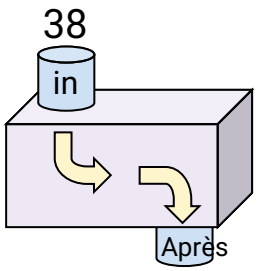

Soustraire 10

2)

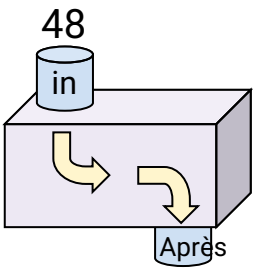

Soustraire 33

3)

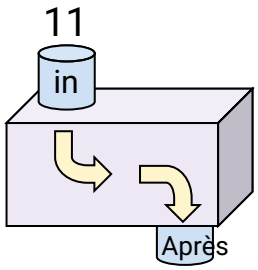

Ajouter 37

4)

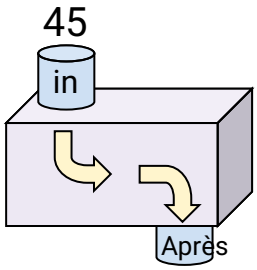

Soustraire 39

5)

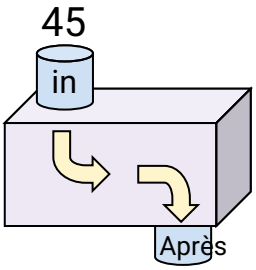

Soustraire 30

6)

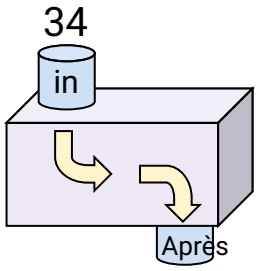

Soustraire 27

7)

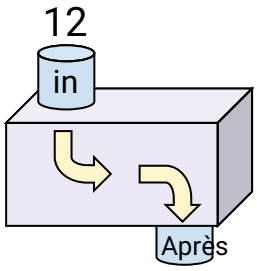

Ajouter 26

8)

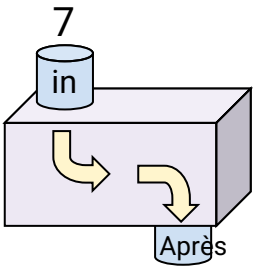

Ajouter 6

9)

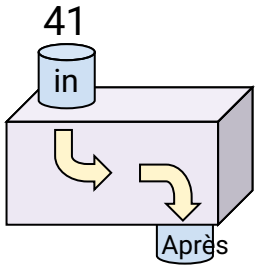

Soustraire 21

10)

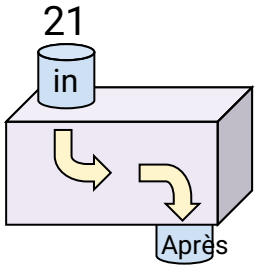

Ajouter 14

11)

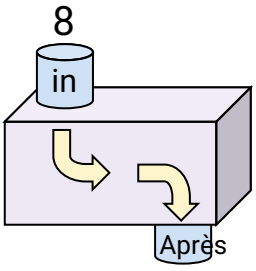

Ajouter 5

Réponses

Ex. Ajouter 22

1. Soustraire 10
2. Soustraire 33
3. Ajouter 37
4. Soustraire 39
5. Soustraire 30
6. Soustraire 27
7. Ajouter 26
8. Ajouter 6
9. Soustraire 21
10. Ajouter 14
11. Ajouter 5