Déterminer la Symétrie

Nom:

Déterminez si la droite qui parcoure la figure est un axe de symétrie.

Ex)

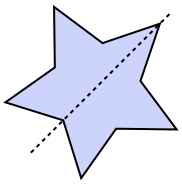

1)

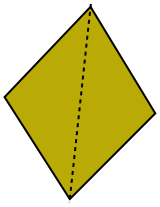

2)

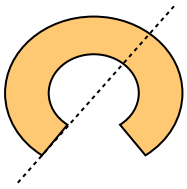

3)

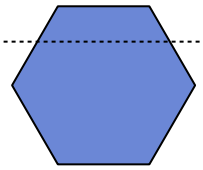

4)

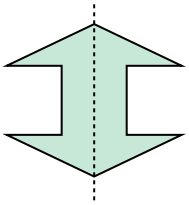

5)

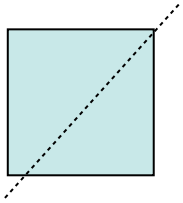

6)

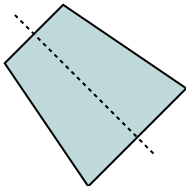

7)

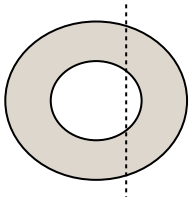

8)

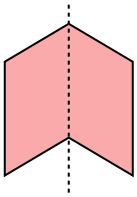

9)

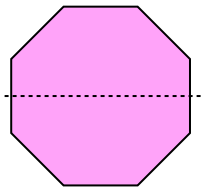

10)

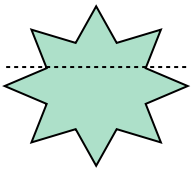

11)

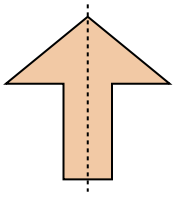

Réponses

Ex. oui

1. _____

2. _____

3. _____

4. _____

5. _____

6. _____

7. _____

8. _____

9. _____

10. _____

11. _____

1-10	91	82	73	64	55	45	36	27	18	9
11	0									

Déterminer la Symétrie

Nom: **Clé**

Déterminez si la droite qui parcoure la figure est un axe de symétrie.

Ex)

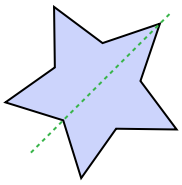

1)

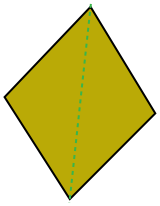

2)

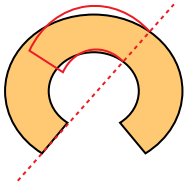

3)

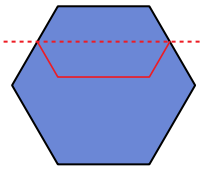

4)

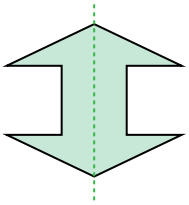

5)

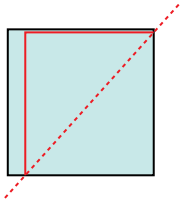

6)

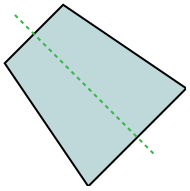

7)

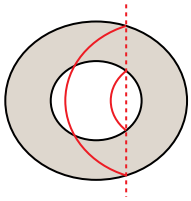

8)

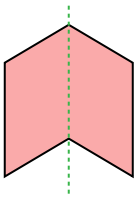

9)

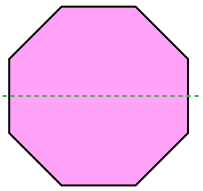

10)

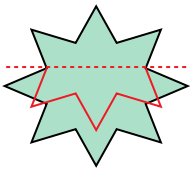

11)

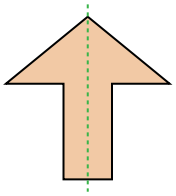

Réponses

Ex. **oui**

1. **oui**
2. **no**
3. **no**
4. **oui**
5. **no**
6. **oui**
7. **no**
8. **oui**
9. **oui**
10. **no**
11. **oui**

1-10	91	82	73	64	55	45	36	27	18	9
11	0									