Compter des Figures Nom:

Comptez le nombre de figure de chaque boîte.



Ex) = 5

1) = _____

2) = _____

3) = _____



4) = _____

5) 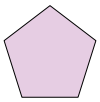 = _____

6) = _____

7) = _____

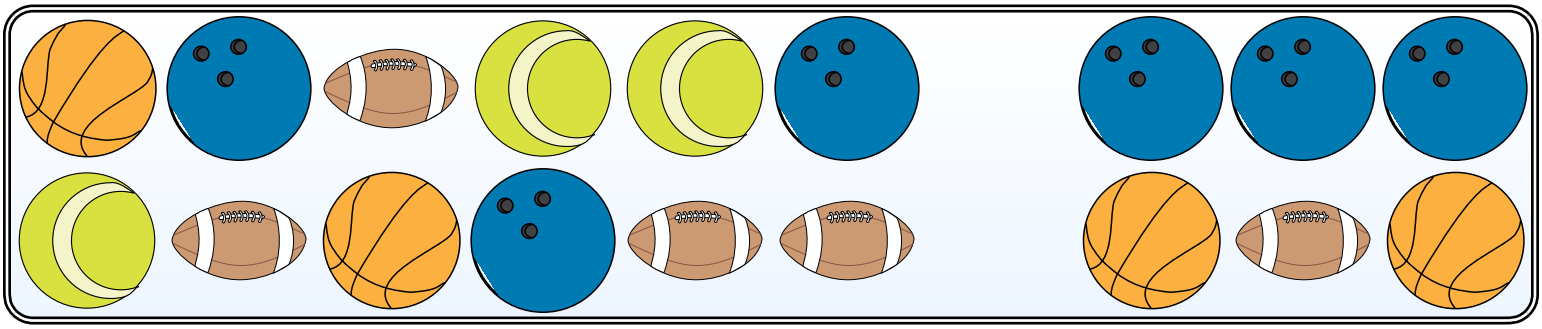

8) = _____

9) = _____

10) = _____

11) = _____

1-10	91	82	73	64	55	45	36	27	18	9
11	0									

Compter des Figures Nom: **Clé**

Comptez le nombre de figure de chaque boîte.



Ex) = 5

1) = 5

2) = 3

3) = 3



4) = 6

5) 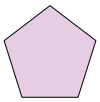 = 4

6) = 5

7) = 4

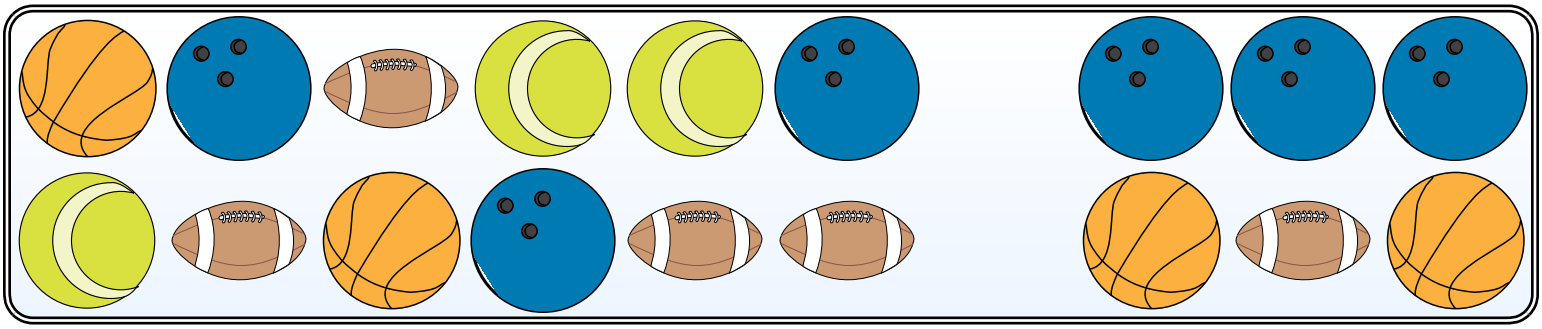

8) = 4

9) = 6

10) = 5

11) = 3

1-10	91	82	73	64	55	45	36	27	18	9
11	0									