Comptage Visuel (Inférieur à 20) Nom:

**Remplir les blancs pour trouver les montants.**

**Ex)**

0 4

dizaines unités

**1)**

dizaines unités

**2)**

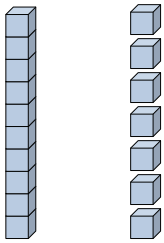

dizaines unités

**3)**

dizaines unités

**4)**

dizaines unités

**5)**

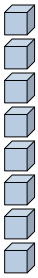

dizaines unités

**6)**

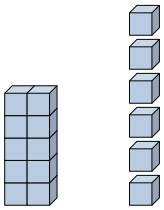

dizaines unités

**7)**

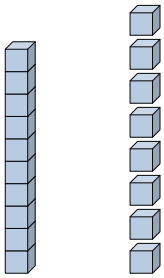

dizaines unités

**8)**

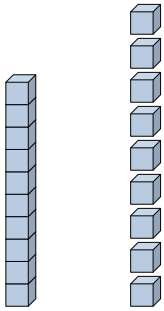

dizaines unités

**9)**

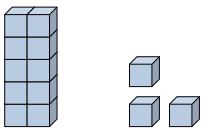

dizaines unités

**10)**

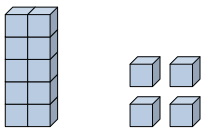

dizaines unités

**11)**

dizaines unités

## Réponses

Ex. 4

1. _____
2. _____
3. _____
4. _____
5. _____
6. _____
7. _____
8. _____
9. _____
10. _____
11. _____



| | | | | | | | | | | |
|---|---|---|---|---|---|---|---|---|---|---|
| 1-10 | 91 | 82 | 73 | 64 | 55 | 45 | 36 | 27 | 18 | 9 |
| 11 | 0 | | | | | | | | | |

Comptage Visuel (Inférieur à 20) Nom: **Clé**

**Remplir les blancs pour trouver les montants.**

**Ex)**

0 dizaines 4 unités

**1)**

0 dizaines 9 unités

**2)**

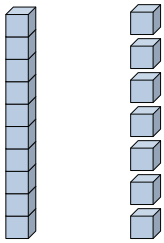

1 dizaines 7 unités

**3)**

0 dizaines 1 unités

**4)**

0 dizaines 5 unités

**5)**

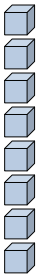

0 dizaines 8 unités

**6)**

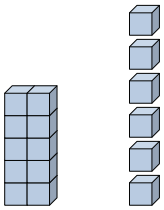

1 dizaines 6 unités

**7)**

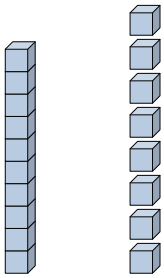

1 dizaines 8 unités

**8)**

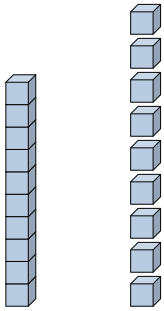

1 dizaines 9 unités

**9)**

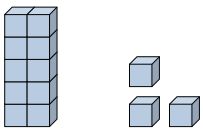

1 dizaines 3 unités

**10)**

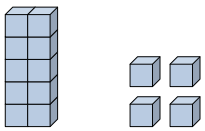

1 dizaines 4 unités

**11)**

0 dizaines 2 unités

## Réponses

| | |
|---|---|
| Ex. | 4 |
| 1. | 9 |
| 2. | 17 |
| 3. | 1 |
| 4. | 5 |
| 5. | 8 |
| 6. | 16 |
| 7. | 18 |
| 8. | 19 |
| 9. | 13 |
| 10. | 14 |
| 11. | 2 |



| | | | | | | | | | | |
|---|---|---|---|---|---|---|---|---|---|---|
| 1-10 | 91 | 82 | 73 | 64 | 55 | 45 | 36 | 27 | 18 | 9 |
| 11 | 0 | | | | | | | | | |